Realiza las operaciones con el dominó

Nombre:

Calco Nº:

= 6 + 1 = ☐

= ☐ + ☐ = ☐

= ☐ + ☐ = ☐

= ☐ + ☐ = ☐

= ☐

= ☐

= ☐

= ☐

= ☐

= ☐

= ☐

= ☐

Suma las piezas para saber cuántos puntos hay. ¡No vale contar!

8

= + =

9

= + =

= + =

= + =

= + =

= + =

Ahora haz toda la suma directamente

 = ☐

 = ☐

 = ☐

 = ☐

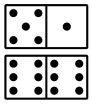 = ☐

 = ☐

 = ☐

 = ☐

Realiza las operaciones con el dominó

Nombre:

Calco Nº:

= 6 + 1 = ☐

= ☐ + ☐ = ☐

= ☐ + ☐ = ☐

= ☐ + ☐ = ☐

= ☐

= ☐

= ☐

= ☐

= ☐

= ☐

= ☐

= ☐

Suma las piezas para saber cuántos puntos hay. ¡No vale contar!

= 8 + 9 = ☐

= ☐ + ☐ = ☐

= ☐ + ☐ = ☐

= ☐ + ☐ = ☐

= ☐ + ☐ = ☐

= ☐ + ☐ = ☐

Ahora haz toda la suma directamente

 = ☐

 = ☐

 = ☐

 = ☐

 = ☐

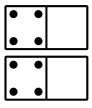 = ☐

 = ☐

 = ☐

Realiza las operaciones con el dominó

Nombre:

Calco Nº:

= 6 + 1 =

= + =

= + =

= + =

=

=

=

=

=

=

=

=

Suma las piezas para saber cuántos puntos hay. ¡No vale contar!

8

= + =

9

+ =

+ =

+ =

+ =

+ =

Ahora haz toda la suma directamente

 =

 =

 =

 =

 =

 =

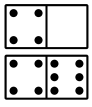 =

 =